Name:_____ Date:_____

Telling Time- Half Hour

Write the time on the clock.

1. 
2:00

2. 
12:30

3. 
5:30

4. 
9:30

5. 
7:00

6. 
8:30

7. 
3:00

8. 
12:00

9. 
4:30

10. 
10:00

11. 
6:00

12. 
2:30

13. 
11:30

14. 
10:30

15. 
9:00