Name:_____

Label the number equivalencies

Thirds

Fraction

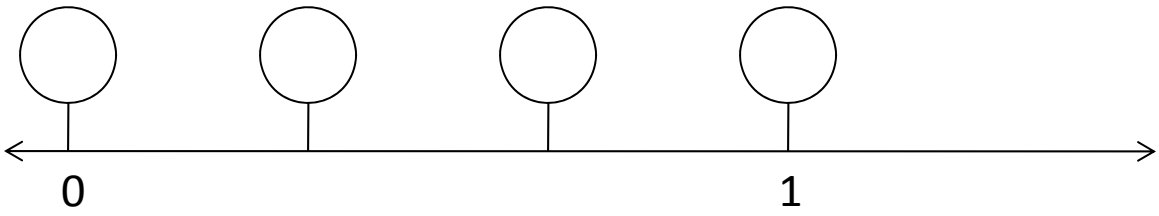

Decimal

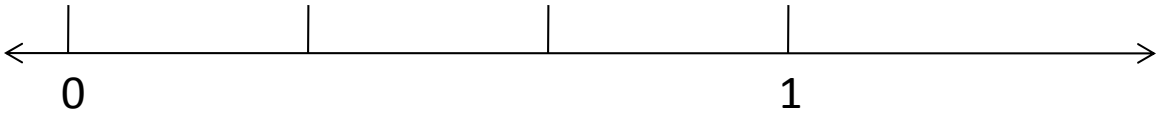

Percent

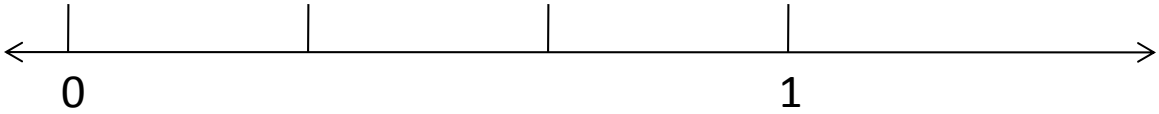

Demonstrate the equivalencies:

The percent 33% is equal to the decimal _____.

The fraction 1/3 is equal to the percent _____.

The decimal 0.66 is equal to the fraction _____.

The percent 100% is equal to the fraction _____.

The fraction 2/3 is equal to the decimal _____.

The decimal 0.0 is equal to the percent _____.

Draw picture of something with thirds or that has three parts: